Name Date

IDENTIFY FACES ON 3D SHAPES 2

Tick the correct box to describe the number of faces.

	Shape	Question	None	One	More than one
1)	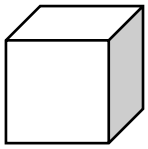	How many square faces?			
2)	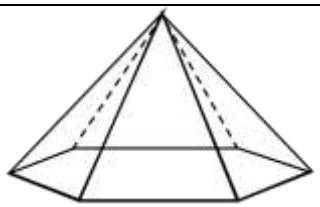	How many triangle faces?			
3)	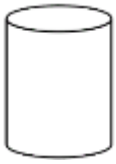	How many rectangle faces?			
4)		How many rectangle faces?			
5)	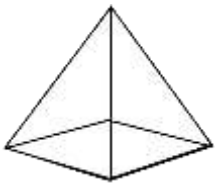	How many square faces?			
6)	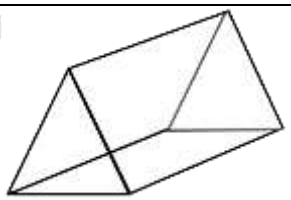	How many triangle faces?			
7)		How many triangle faces?			

Name Date

IDENTIFY FACES ON 3D SHAPES 2 ANSWERS

Tick the correct box to describe the number of faces.

	Shape	Question	None	One	More than one
1)	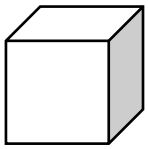	How many square faces?			✓
2)	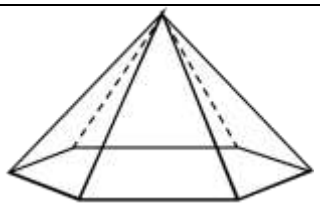	How many triangle faces?			✓
3)	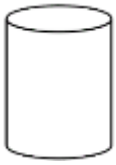	How many rectangle faces?	✓		
4)		How many rectangle faces?			✓
5)	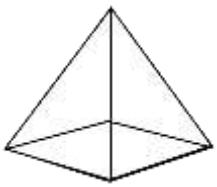	How many square faces?		✓	
6)	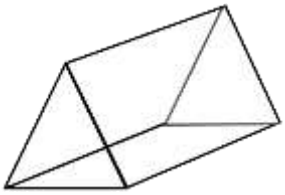	How many triangle faces?			✓
7)		How many triangle faces?	✓		